Oxford Cambridge and RSA

A Level Geography
H481/03 Geographical debates
Sample Resource Booklet

Time allowed: 2 hour 30 minutes

INFORMATION FOR CANDIDATES

- The questions tell you which resources you need to use.
- This document consists of **8** pages. Any blank pages are indicated.

INSTRUCTIONS TO EXAMS OFFICER/INVIGILATOR

- Do not send this Resource Booklet for marking, it should be retained in the centre or recycled. Please contact OCR copyright should you wish to re-use this document.

CONTENTS OF RESOURCE BOOKLET

- Fig.1 – Global temperature variations between 1850 and 2010
- Fig.2 – Two treatment centres – one in a LIDC and one in an AC
- Fig.3 – An extract adapted from a text on oceans
- Fig.4 – Global distribution of working tractors per 1000 people by country 2014
- Fig.5 – Earthquake magnitude and deaths for selected events since 2001

Draft

Fig. 1 – Global temperature variations between 1850 and 2010

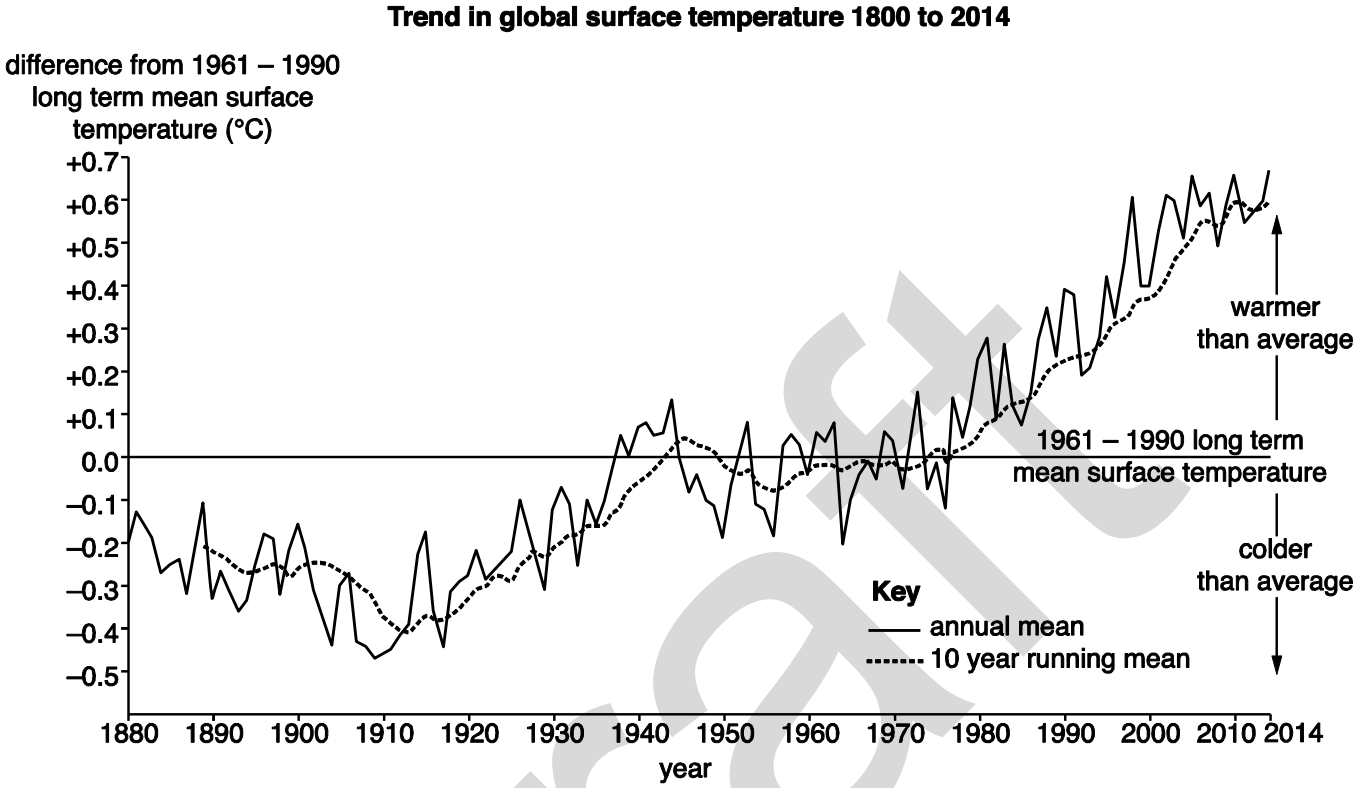

Draft

Fig. 2 – Two treatment centres – one in a LIDC and one in an AC

Draft

Fig. 3 – An extract adapted from a text on oceans

As human populations and their expectations grow, demand for resources also grows. Oceanic resources of all types, biological, mineral and energy, are no exception to this trend. In the past and continuing today, ocean resources have sometimes been exploited to such an extent that supply of the resource declined. This has often been the result of advances in technology allowing more of a resource to be exploited. However, the relationship between demand for a resource and its supply is receiving increasing attention locally, regionally and globally.

Fig. 4 – Global distribution of working tractors per 1000 people by country 2014

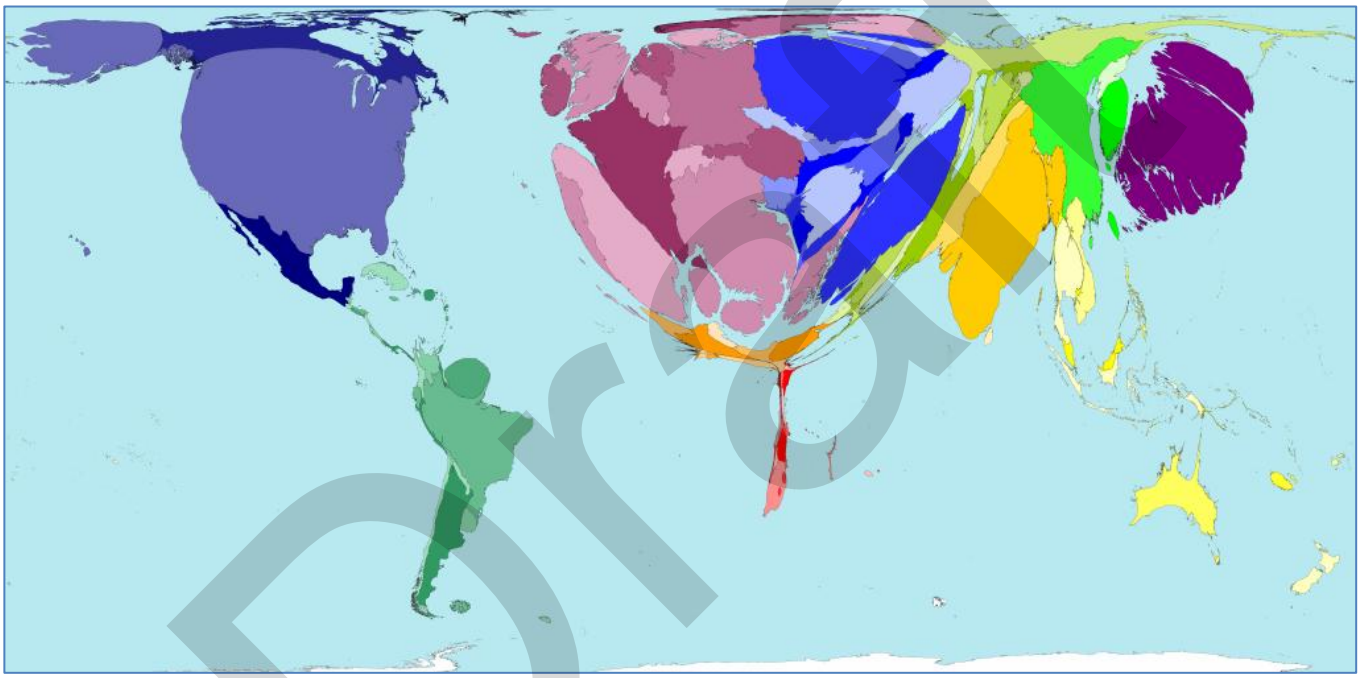

The size of each country represents the proportion of all working tractors (per 1,000 people) that are found in the country. The colours are used to distinguish between different countries.

Draft

Fig. 5 – Earthquake magnitude and deaths for selected events since 2001

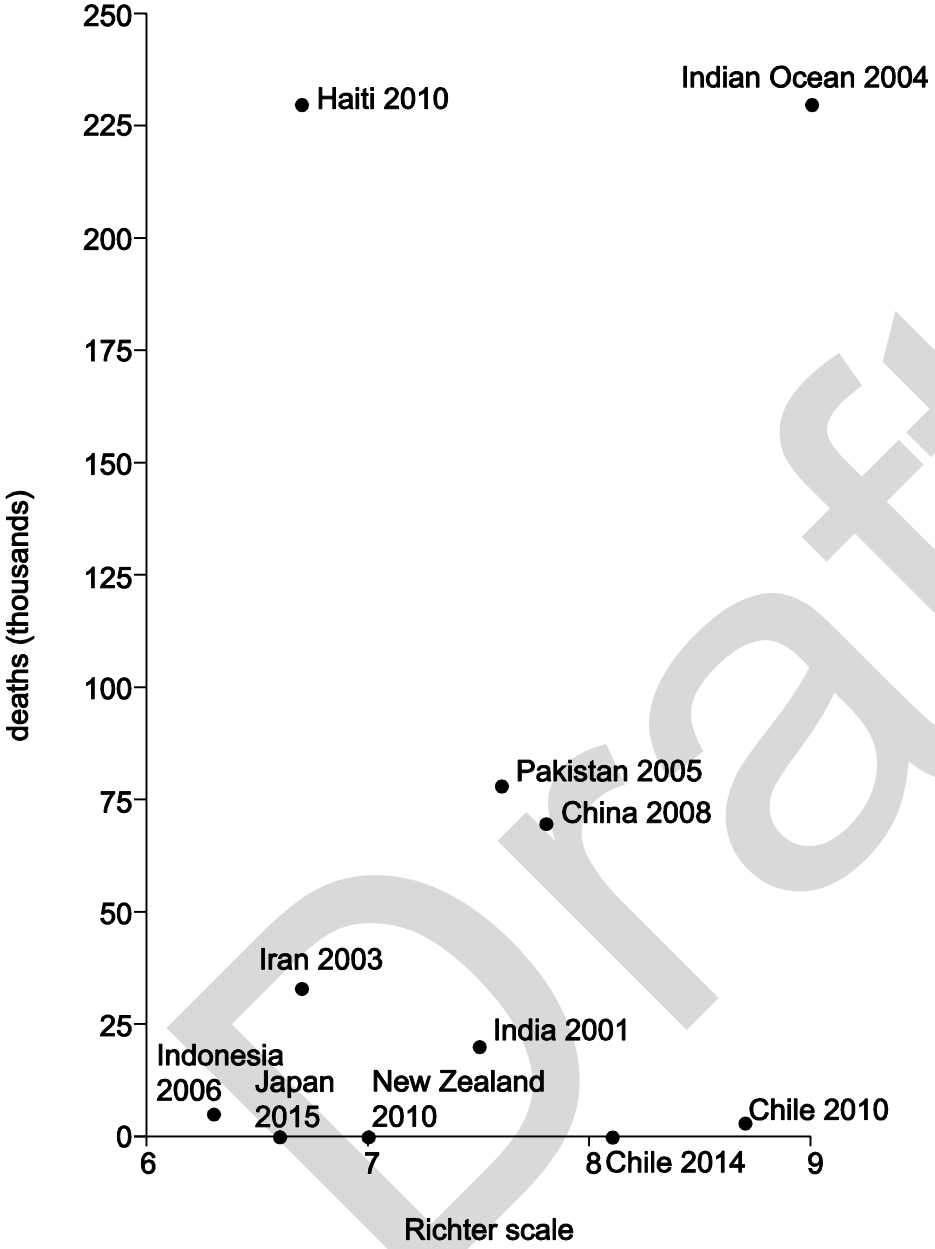

Draft

BLANK PAGE

Draft

BLANK PAGE

Draft

Draft

Copyright Information:

Fig.2: © Jake Lyell. Image supplied by Alamy, www.alamy.com - Image: (Ref: D161F3)
Fig.3: © VIEW Pictures Ltd. Image supplied by Alamy, www.alamy.com - Image: (Ref: CY3TJ5)
Fig.4: Working Tractors World Map. © Copyright Sasi Group (University of Sheffield) and Mark Newman (University of Michigan). Reproduced under the terms of the Creative Commons Attribution-NonCommercial-NoDerivs 3.0 Unported Licence, www.creativecommons.org

OCR is committed to seeking permission to reproduce all third-party content that it uses in the assessment materials. OCR has attempted to identify and contact all copyright holders whose work is used in this paper. To avoid the issue of disclosure of answer-related information to candidates, all copyright acknowledgements are reproduced in the OCR Copyright Acknowledgements booklet. This is produced for each series of examinations and is freely available to download from our public website (www.ocr.org.uk) after the live examination series.

If OCR has unwittingly failed to correctly acknowledge or clear any third-party content in this assessment material, OCR will be happy to correct its mistake at the earliest possible opportunity.

For queries or further information please contact the Copyright Team, First Floor, 9 Hills Road, Cambridge CB2 1GE.

OCR is part of the Cambridge Assessment Group; Cambridge Assessment is the brand name of University of Cambridge Local Examinations Syndicate (UCLES), which is itself a department of the University of Cambridge.